Time: 10 Minutes **Paper Math 5** **Total Marks: 10**

6th Month, 1st Week, 1st Day	**Syllabus: Unit 8:** Exercise # 1 Q # 1, 2, 3, 4

Q.No.1. Find the perimeter of the given squares: **(10)**

سوال نمبر1: درج ذیل مربعوں کا احاطہ معلوم کریں:

(i)

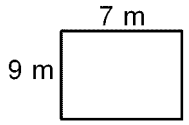

(ii)

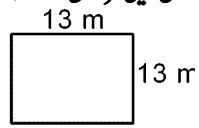

Q.No.2. Find the perimeter of the given rectangles: **(5)**

سوال نمبر2: دی گئی مستطیل کا احاطہ معلوم کریں:

(i)

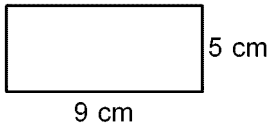

(ii)

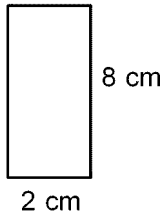

1

Time: 10 Minutes **Paper Math 5** **Total Marks: 10**

6th Month, 1st Week, 1st Day	**Syllabus: Unit 8:** Exercise # 1 Q # 1, 2, 3, 4

Q.No.1. Find the perimeter of the given squares: **(10)**

سوال نمبر1: درج ذیل مربعوں کا احاطہ معلوم کریں:

(i)

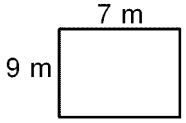

(ii)

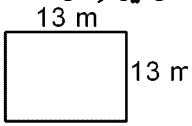

Q.No.2. Find the perimeter of the given rectangles: **(5)**

سوال نمبر2: دی گئی مستطیل کا احاطہ معلوم کریں:

(i)

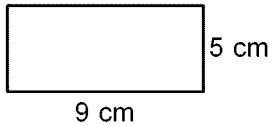
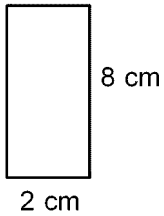
(ii)